Tuesday 3rd November 2026
WALT: Make Prendictions about charact

spider	sly
~~oh~~ ~~ohe~~ oh no she resuosing to cum I ~~meadt~~ must sined a nuser way to mayeher cum Im starsing I dont hoth a nuth money to get sood of my sarser so I will get my mony to ceop this hoves are sinsk sink. Maybea I coed gest grab her no my ~~dad~~ sarser ~~sed~~ I said I had to get slis ~~bt~~ by tricking them maby I coed ~~seey~~ saiy I woed sis her sum sood ar I dont nowe ~~wat~~ what to do!	I dont nowe ~~wot~~ what to do ~~wat~~ what is I am mising out but asow ~~wat~~ what If ~~y~~ he's the nesing my dad lest and I asoll hasint have'd sood in a hole wheack ~~ara~~ ar I dont now ~~wat~~ what to do this is so anoying. ~~mu~~ maby I coed send in a srend and seaith he cums out alis no to riscy ~~myabyby~~ maby I can ~~gt~~ get some sood and triand ~~sing~~ sind ~~at~~ my dad and If I do we will both trey ~~sing~~ sind a ~~wat~~ ~~weah~~ weah out ar my brayn herts I dont nowe what to do!



3.11.26

The Three Jewels

The Buddha

The Dharma:
The teaching of the Buddha.

The Sangha:
The community of Buddhist monks and nuns.

Buddhists trust the three jewels to help them on their path to enlightenment. They are described as jewels because they are precious. Choose three things that help you achieve what you want in life and design a symbol for each one.



my cat



roblox



Stem

A

Thursday 1st October 2026

LO – to use inference to say what is happening in a picture & to punctuate my writing correctl



- ~~Give~~ cat and Cookie the creatures names.
- What has just happened?
- Why is the green creature wearing a chef's hat?
- How is the creature feeling?
- What might happen next?

Sentence starters:

I think...

I think this because...

The creature might be feeling.. because...

I think next...

Task

To write some sentences explaining what is going on in this picture.

I think the cat is called cat and the creature (creacher) is called cookie muncher because they are cute and need cute names. I think that he has just stayed up late to bake all these cookies and tried one and while he was eating the tasty chocolate (cochlet) chip cookies the cat tipped it over. I think this because the cat looks really (rellly) guilty (cutty) but also jugmented. The cookie monster might be felling tired and sad because he wookked (worked) rellly hard on the cookies and cat the cat ruined it and it looks like he worked all day on them because it's dar(k) out side. I think he is wearing a chef's hat (hu) because he is the one that baked the cookies. he looks like he is suprised and upset because the cookies are ruined. I think next the cookie monster is going to have to clean up it's going to take him all night to clean up and he is going to be even more tired and

Grumpy and he is going to go crazy then be a big and scary monster and scare all of the people in the town and he is going to fall asleep and go back to a kind and calm monster and I think that because when I dont sleep I geet realy mad and grumpy and he looks already a bit grumpy and Tired.

NEXT STEP: What do you think happened in the five minutes before this picture was taken?

He Was Makeing Cookies

Tuesday 22nd September 2026
LO: To write a persuasive argument

I

Dear miss Headteacher,

I am writing to tell you about some idea for our school.

First, I belive that students who bully should be either put on suspension, icelachon or a shorter play/break. I feal like it is extra unacceptable and stunts their growth at socilising and self confidence. No one should have to experience that.

I also think that, we should be allowed gum in class. Science proves that it increa focus by around 10% in adults (and done the research) so in children by an acedemic guess it should help children by about double which is 20%.

Finally, I think that, Pe and art should get a full day a week on them because Pe gets you energised and art calm you down

I thank you perfusely for reading my letter

Yours amazingly sincerly,

Which Faiths Are in the UK Today?

To compare different beliefs/faiths.

Use the **Which Faiths Are in the UK Today? Fact Sheet** to help you complete the following questions and activities.

Label the religious symbols with the correct religions.



christianity



Hindu dharma



Islam



Taoism



Judaism



Humanism



Sikhi



Buddhism

Which three religions believe in one God?

christianity Islam Judaism

What else do they have in common?

Abraham. Adam Eve

Which faith doesn't believe in a god? What do people of this faith follow instead?

Humanism dot follow a god Ther blefs in science.

Tuesday 3rd November 2026.

L.I. to make predictions about characters.

The Spiders thoughts.	The girls thoughts.
• I need to lure her to my parlor for my trap.	• I cant not going in there with that big, Scheeaing, blood thirsty monster spider.
• She is way to smart... its past my dinner time and i am still way to hungery for her dumb plans!	• Maybe his parlor has tea and chese? but it could be a bad trap to eat and kill me.



• She better not try and run from me or I will eather right here in the hallway.

• This spider is going to eat me soon so i have to run away but if i run he will eat me all up in the jeild

• She will love my parlor • he is so ugly! Where i will eather!

06.10.26

Read and write numbers to 1,000,000

Maths

1 What number is represented?

Thousands			Ones		
H	T	O	H	T	O
●●	●●	●●	●	●●	●●
●	●			●●	●●
	●				●

Write your answer in numerals.

352,146 ✓

Write your answer in words.

3 Hundred 52 Tusand and 146. three hundred and fifty-two thousand, one hundred and fortysix

2 What number is represented?

HTh	TTh	Th	H	T	O
●●	●●	●●	●●	●●	●●
	●		●●		●●
			●		

Write your answer in numerals.

232,524 ✓

Write your answer in words.

2 Hundred 32 thousand and 524. Two hundred and thirty-two thousand, five hundred and twenty four

3 **a)** Eva has written the number 231,405 in words.

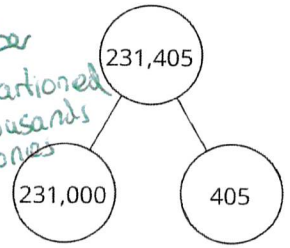

• The number has been partioned into the thousands part and the ones part

two hundred and thirty-one thousand, four hundred and five

How does the part-whole model help Eva? shan the number

b) Complete the part-whole model and write the number in words.

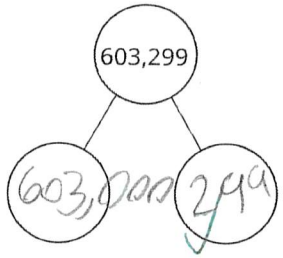

Six Hundred and 3 thousand tow Hundr and ninenine

4 **a)** Draw counters in the charts to represent the number two hundred and thirty thousand, four hundred and thirteen.

Thousands			Ones		
H	T	O	H	T	O
●●	●●●	●	●●●●	●●	●●●
			●●		

HTh	TTh	Th	H	T	O
●●	●●		●●●	●	●●
	●				●

What is the same? What is different?

b) Write the number in numerals.

230,413 ✓

© White Rose Maths 2022

2/11/26

Round to the nearest 10, 100 or 1,000

1 Use the number line to help you complete the sentences.

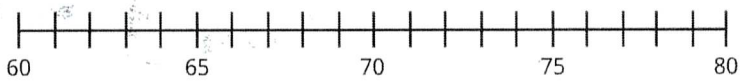

63 rounds to 60 to the nearest 10

74 rounds to 70 to the nearest 10

67 rounds to 70 to the nearest 10

78 rounds to 80 to the nearest 10

2 Round each number to the nearest 10

a) 48 50 548 550

248 250 1,748 1,750

b) What do you notice about your answers in part a)?

All 50

3 Round each number to the nearest 100

a) 1,532 1500 1,552 1600

1,542 1500 1,562 1600

b) What do you notice about your answers in part a)?

1,600

4 Round the numbers to the correct values.

a)	**743**	**b)**	**9,867**
to the nearest 10 is	740	to the nearest 10 is	9870
to the nearest 100 is	700	to the nearest 100 is	9900
to the nearest 1,000 is	1,000	to the nearest 1,000 is	10,000

5 **a)** Circle the numbers that round to 650 when rounded to the nearest 10

653 655 **645** **545** **648** 641

b) Circle the numbers that round to 5,400 when rounded to the nearest 100

5,430 5,450 **5,380** 5,340 **5,425** 5,325

c) Circle the numbers that round to 12,000 when rounded to the nearest 1,000

12,475 **11,780** **12,399** **12,111** **11,999** **11,501**

29/9/26

CVC Words Cut and Paste Worksheet

Directions: Cut and paste the letters to make the word for the picture in the box.

t a







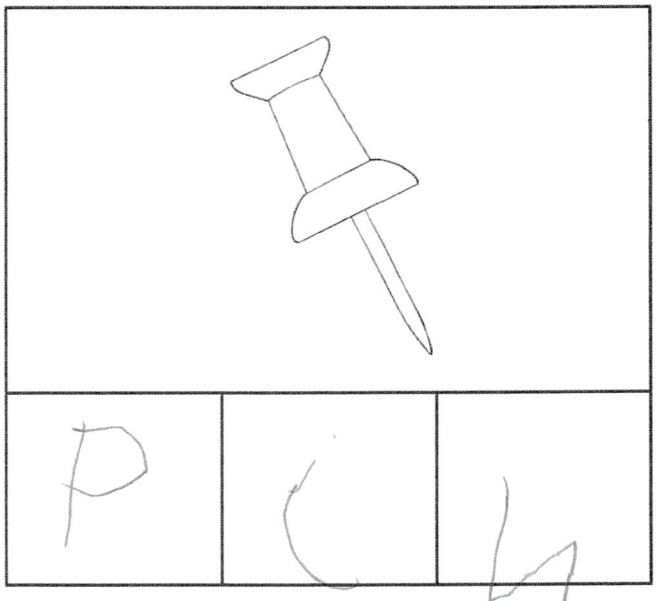

twinkl

visit twinkl.com

twinkl Quality Standard Approved

s	a	a	p	t	i
t	p	t	a	p	n

4.11.26 LO: to recognise & write S, a, t.

